TOPIC 33 · DECIMALS, PERCENTS & FRACTIONS

Estimating Fraction of a Whole, given Figure

Name _____

Date _____

Score _____ / 10

●●○ Medium 10 questions about 12 minutes

Directions: Choose the best answer and circle its letter. You may write in this booklet. No calculator.

1 About what fraction of the figure is shaded?



(A) $\frac{1}{4}$ (B) $\frac{9}{10}$ (C) $\frac{1}{2}$ (D) $\frac{2}{3}$

2 About what fraction of the circle is shaded?



(A) $\frac{1}{4}$ (B) $\frac{1}{2}$ (C) $\frac{1}{10}$ (D) $\frac{3}{4}$

3 About what fraction of the figure is shaded?



(A) $\frac{9}{10}$ (B) $\frac{1}{4}$ (C) $\frac{1}{10}$ (D) $\frac{2}{3}$

4 About what fraction of the circle is shaded?



(A) $\frac{3}{4}$ (B) $\frac{1}{4}$ (C) $\frac{1}{2}$ (D) $\frac{1}{10}$

5 About what fraction of the figure is shaded?



(A) $\frac{1}{4}$ (B) $\frac{1}{3}$ (C) $\frac{2}{3}$ (D) $\frac{9}{10}$

6 About what fraction of the circle is shaded?



(A) $\frac{9}{10}$ (B) $\frac{1}{4}$ (C) $\frac{1}{2}$ (D) $\frac{3}{4}$

Preview - the full worksheet and its answer key are at primeworksheet.com