Name _____ Date _____ Per _____

GRADE 6 MATH · HOMEWORK

Interpret a Box Plot

SCORE / 25

01 Part A · Practice

Each whisker and each half of the box holds about one fourth of the data; the box shows the middle half.

1 ●○○ About what percent of the data are between 63 and 78?

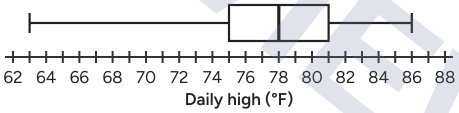

2 ●○○ Use the box plot. Find the range and the interquartile range (IQR).

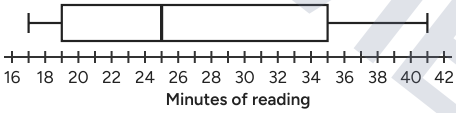

3 ●○○ Use the box plot. What are the lower quartile and the maximum?

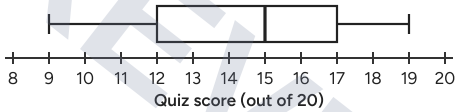

4 ●○○ Use the box plot. What are the upper quartile and the minimum?

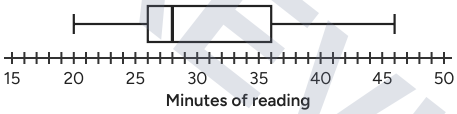

5 ●○○ Use the box plot. Find the range and the interquartile range (IQR).

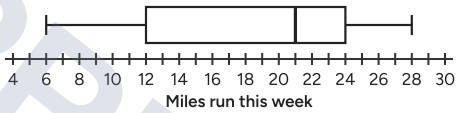

6 ●○○ About what percent of the data are less than 22?

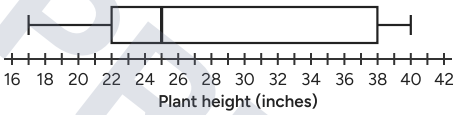

7 ●○○ Use the box plot. What are the lower quartile and the minimum?

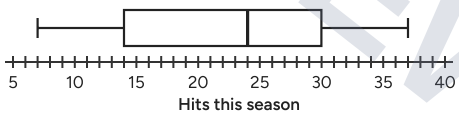

8 ●○○ Use the box plot. Find the range and the interquartile range (IQR).

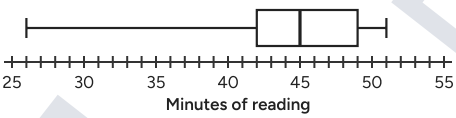

© 2026 Math Teacher Prints · 8-3c Homework · Regular

PREVIEW

Preview - the full worksheet and its answer key are at primeworksheet.com